# 第四单元测试

Unit 4 · End-of-Unit Assessment

| 名字：_____ Name | 学号： Number |
| --- | --- |

## End-of-Unit Assessment 单元测试

**1.** How many shapes are there? 一共有几个图形？



_____

- - - - - - - -

_____

**2.** There are 3 stickers on the book.
Then Jada puts 2 more stickers on the book.
How many stickers are on the book now?

书上有 3 张贴纸。
Jada 又贴了 2 张。
现在书上有几张贴纸？

Show your thinking using objects, drawings, numbers, or words. 用实物、图画、数字或文字表示你的想法。

**3.** There are 6 kids playing in the park.
2 of the kids leave the park to go home.
How many kids are playing in the park now?

公园里有 6 个小朋友在玩。
2 个小朋友回家了。
现在公园里还有几个小朋友在玩？

Show your thinking using objects, drawings, numbers, or words. 用实物、图画、数字或文字表示你的想法。

**4.** Draw a line to match each picture with the expression it shows. 把每幅图和它表示的算式连起来。

A



B

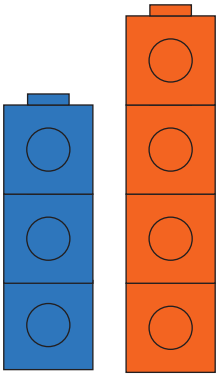

C

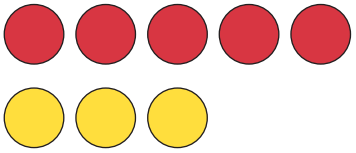

1 3 + 4

2 5 + 3

3 5 − 2

**5.** Write the value of each expression. 写出每个算式的值。

**a.** 2 + 3

**b.** 8 – 1

**c.** 3 + 0